Nome: _____ Data: ____/____/_____

Conte centenas, dezenas e unidades (gabarito)

O quadrado grande vale 100, a barra vale 10 e o quadradinho vale 1. Escreva C, D, U e o número.

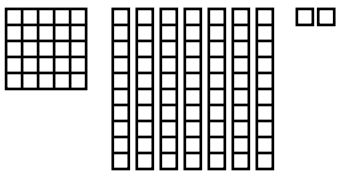

C **1** D **7** U **2** = **172**

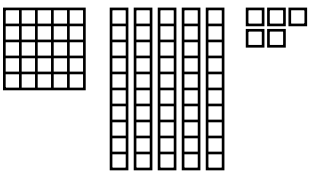

C **1** D **5** U **5** = **155**

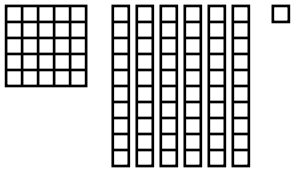

C **1** D **6** U **1** = **161**

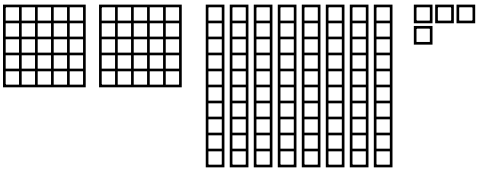

C **2** D **8** U **4** = **284**

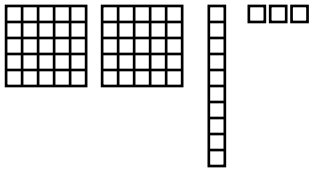

C **2** D **1** U **3** = **213**

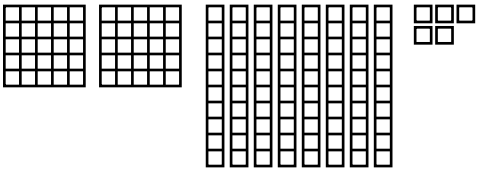

C **2** D **8** U **5** = **285**

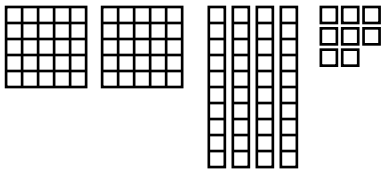

C **2** D **4** U **8** = **248**

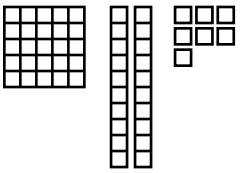

C **1** D **2** U **7** = **127**

Livre para uso em casa e na escola. Não revender ou republicar.