Nome: _____ Data: ____/____/_____

Centenas, dezenas e unidades de 300 a 399 (gabarito)

Conte os blocos de cada quadro e escreva C, D, U e o número.

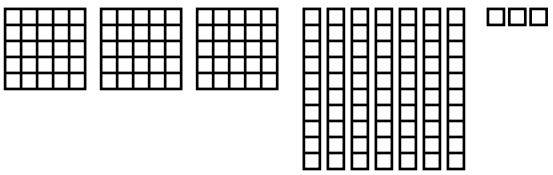

C 3 D 7 U 3 = 373

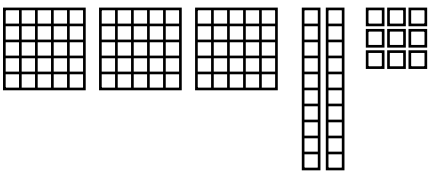

C 3 D 2 U 9 = 329

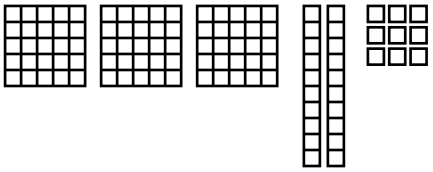

C 3 D 2 U 9 = 329

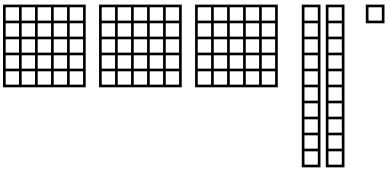

C 3 D 2 U 1 = 321

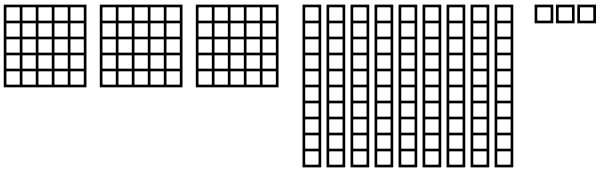

C 3 D 9 U 3 = 393

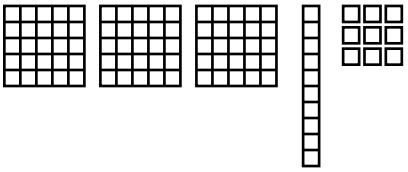

C 3 D 1 U 9 = 319

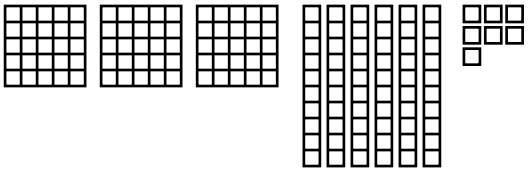

C 3 D 6 U 7 = 367

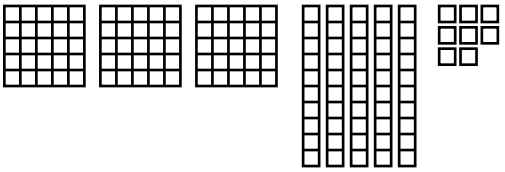

C 3 D 5 U 8 = 358

Livre para uso em casa e na escola. Não revender ou republicar.