Nome: _____ Data: ____/____/_____

Conte centenas, dezenas e unidades

O quadrado grande vale 100, a barra vale 10 e o quadradinho vale 1. Escreva C, D, U e o número.

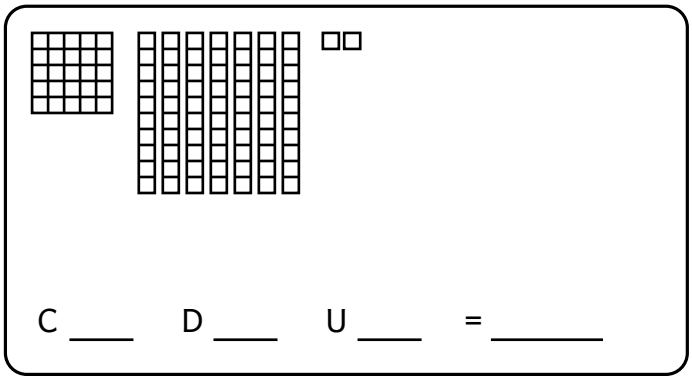

C ____ D ____ U ____ = _____

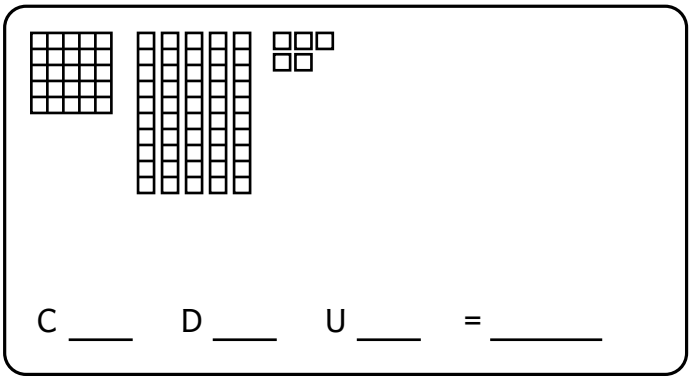

C ____ D ____ U ____ = _____

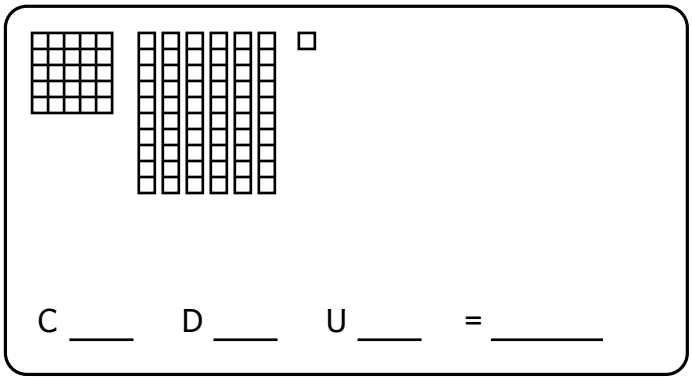

C ____ D ____ U ____ = _____

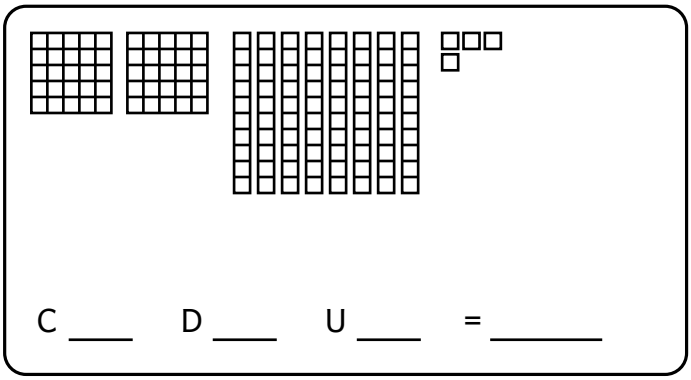

C ____ D ____ U ____ = _____

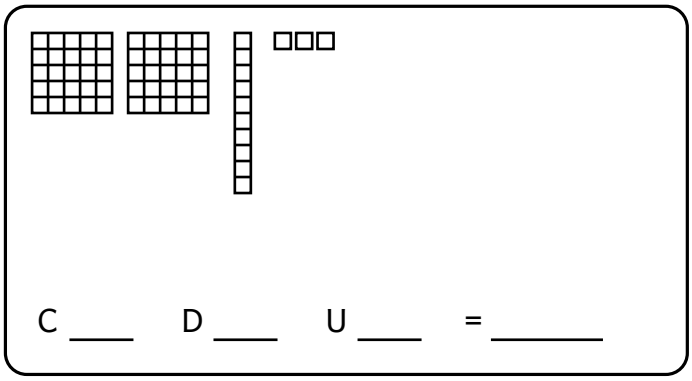

C ____ D ____ U ____ = _____

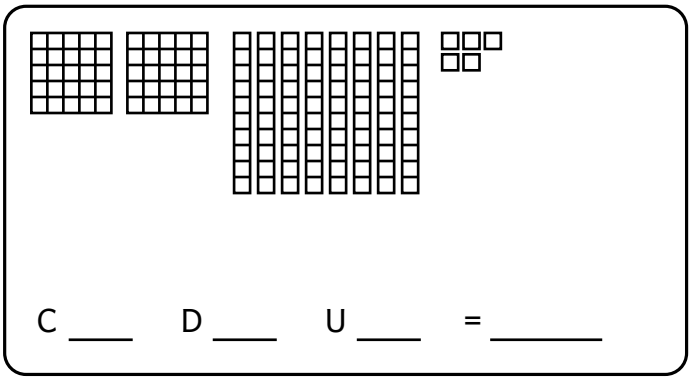

C ____ D ____ U ____ = _____

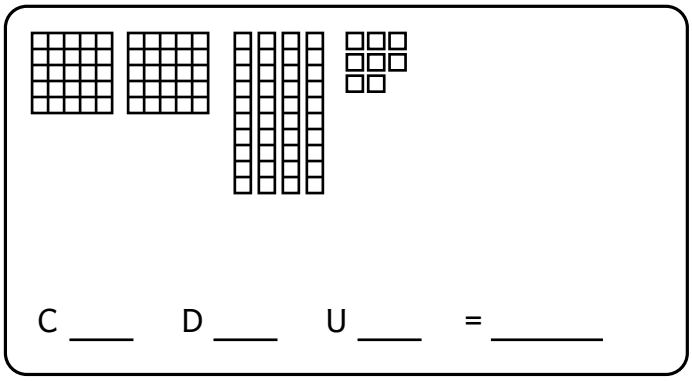

C ____ D ____ U ____ = _____

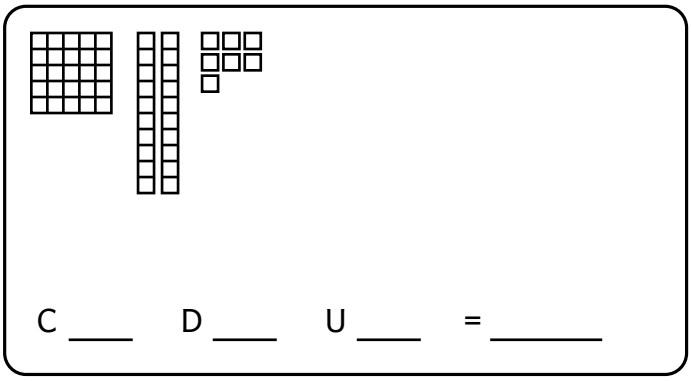

C ____ D ____ U ____ = _____

Livre para uso em casa e na escola. Não revender ou republicar.

Nome: _____ Data: _____/_____/_____

Centenas, dezenas e unidades de 300 a 399

Conte os blocos de cada quadro e escreva C, D, U e o número.

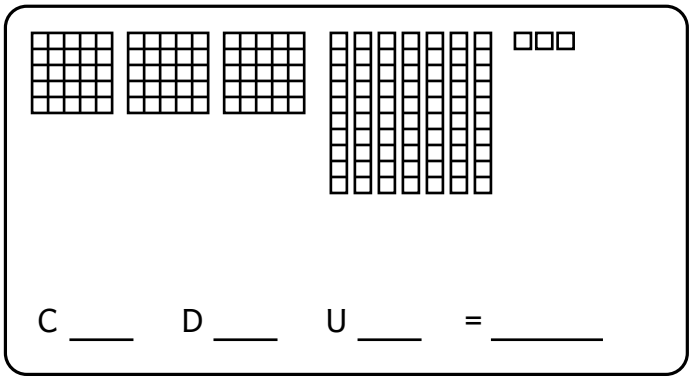

C ____ D ____ U ____ = _____

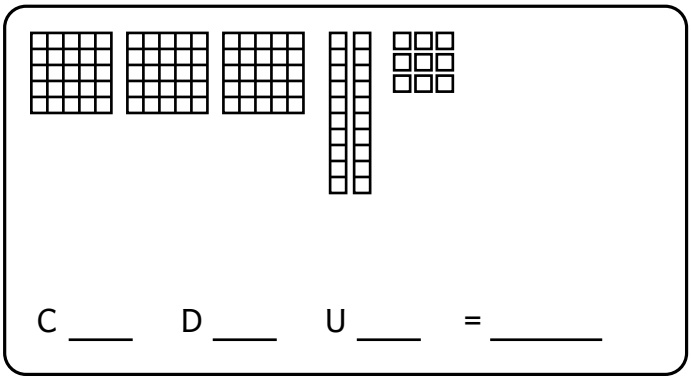

C ____ D ____ U ____ = _____

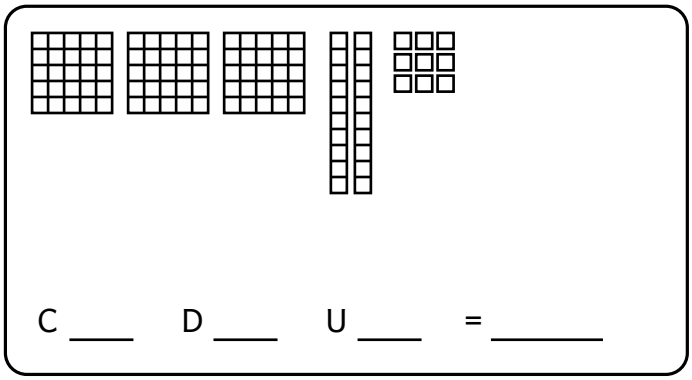

C ____ D ____ U ____ = _____

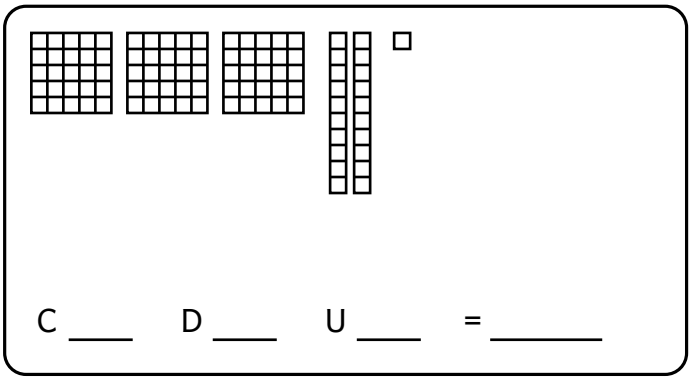

C ____ D ____ U ____ = _____

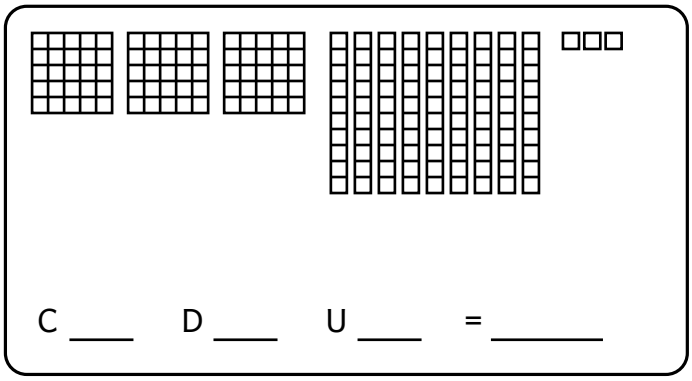

C ____ D ____ U ____ = _____

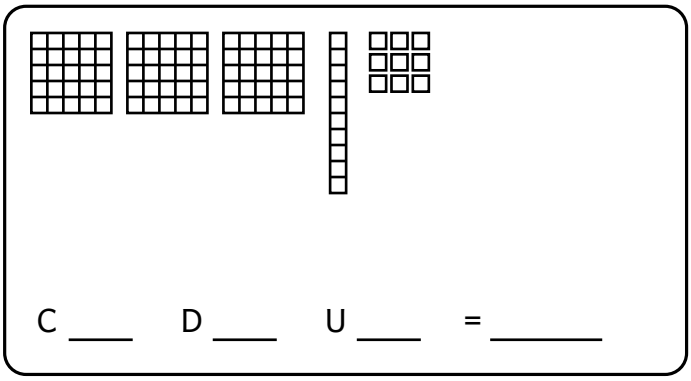

C ____ D ____ U ____ = _____

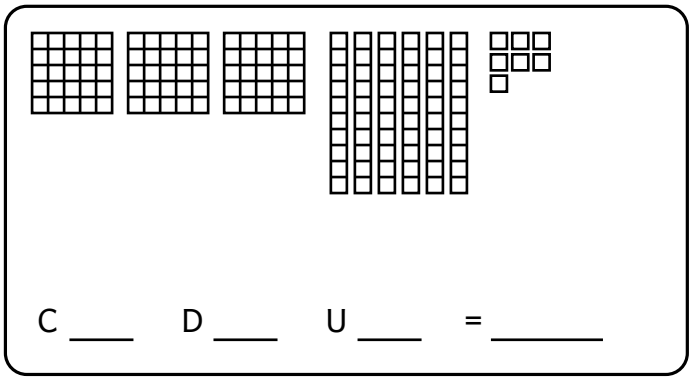

C ____ D ____ U ____ = _____

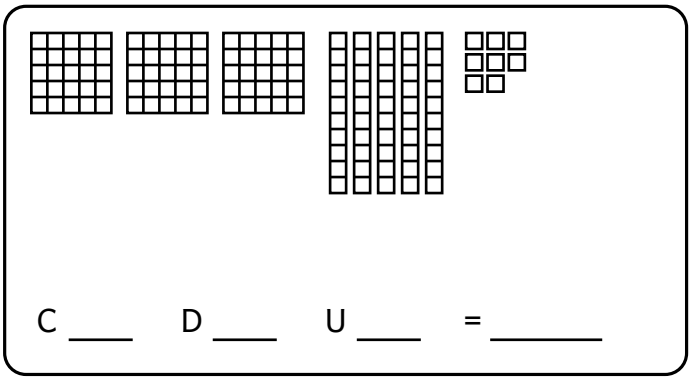

C ____ D ____ U ____ = _____

Livre para uso em casa e na escola. Não revender ou republicar.

Nome: _____ Data: _____/_____/_____

Quantas centenas, dezenas e unidades?

Escreva, para cada número, quantas centenas (C), dezenas (D) e unidades (U) ele tem.

346	C		D		U	
653	C		D		U	
635	C		D		U	
353	C		D		U	
919	C		D		U	
567	C		D		U	
132	C		D		U	
365	C		D		U	
561	C		D		U	
191	C		D		U	
966	C		D		U	
544	C		D		U	
155	C		D		U	
388	C		D		U	
175	C		D		U	

Livre para uso em casa e na escola. Não revender ou republicar.

Nome: _____ Data: _____/_____/_____

Decomponha em centenas, dezenas e unidades

Escreva cada número como soma: 345 = 300 + 40 + 5.

346 = _____

653 = _____

635 = _____

353 = _____

919 = _____

567 = _____

132 = _____

365 = _____

561 = _____

191 = _____

966 = _____

544 = _____

155 = _____

388 = _____

175 = _____

477 = _____

Livre para uso em casa e na escola. Não revender ou republicar.