Nome: _____ Data: _____/_____/_____

Conte as dezenas e as unidades (gabarito)

Cada barra vale 10 e cada quadradinho vale 1. Escreva quantas dezenas e quantas unidades.

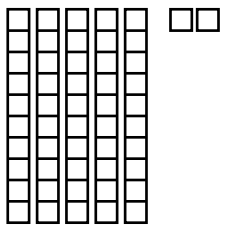

dezenas **5** unidades **2**

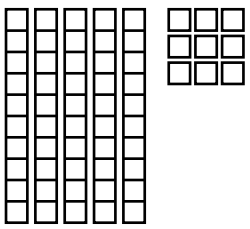

dezenas **5** unidades **9**

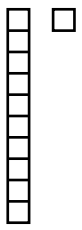

dezenas **1** unidades **1**

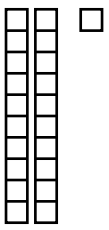

dezenas **2** unidades **1**

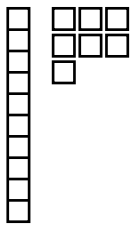

dezenas **1** unidades **7**

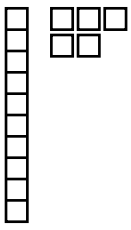

dezenas **1** unidades **5**

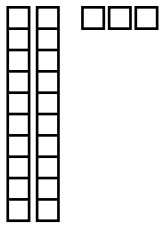

dezenas **2** unidades **3**

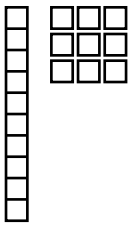

dezenas **1** unidades **9**

Livre para uso em casa e na escola. Não revender ou republicar.