Nome: _____ Data: _____/_____/_____

Conte as dezenas e as unidades

Cada barra vale 10 e cada quadradinho vale 1. Escreva quantas dezenas e quantas unidades.

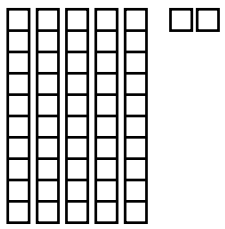

dezenas ____ unidades ____

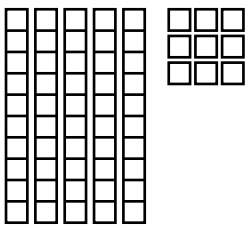

dezenas ____ unidades ____

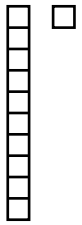

dezenas ____ unidades ____

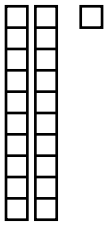

dezenas ____ unidades ____

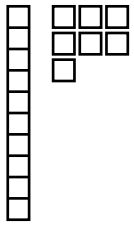

dezenas ____ unidades ____

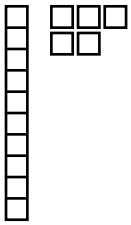

dezenas ____ unidades ____

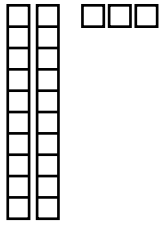

dezenas ____ unidades ____

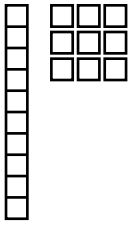

dezenas ____ unidades ____

Livre para uso em casa e na escola. Não revender ou republicar.