Nome: _____ Data: _____/_____/_____

Dezenas e unidades até 99 (gabarito)

Conte as barras e os quadradinhos. Depois escreva as dezenas e as unidades.

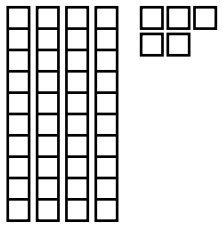

dezenas **4** unidades **5**

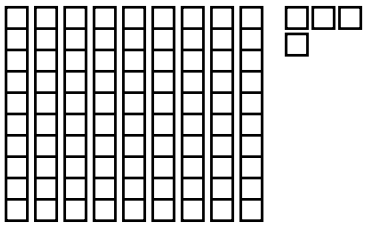

dezenas **9** unidades **4**

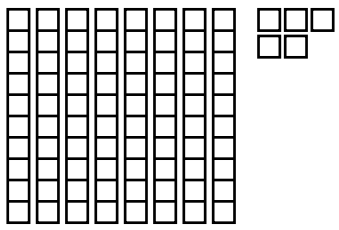

dezenas **8** unidades **5**

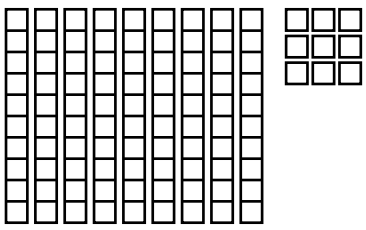

dezenas **9** unidades **9**

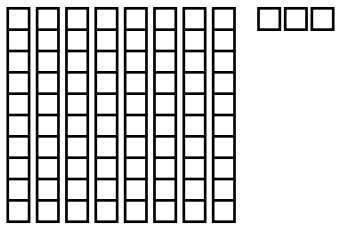

dezenas **8** unidades **3**

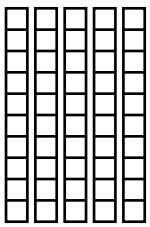

dezenas **5** unidades **0**

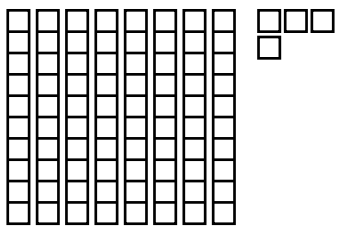

dezenas **8** unidades **4**

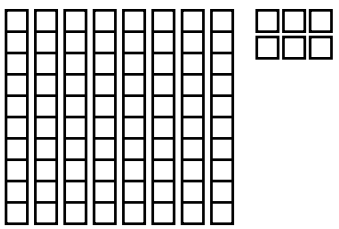

dezenas **8** unidades **6**

Livre para uso em casa e na escola. Não revender ou republicar.