Nome: _____ Data: _____/_____/_____

Dezenas e unidades até 99

Conte as barras e os quadradinhos. Depois escreva as dezenas e as unidades.

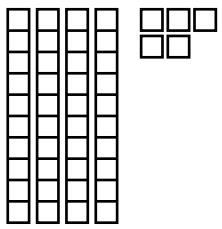

dezenas ____ unidades ____

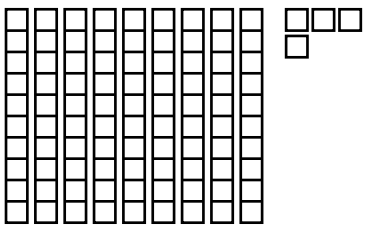

dezenas ____ unidades ____

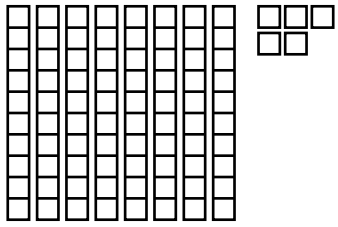

dezenas ____ unidades ____

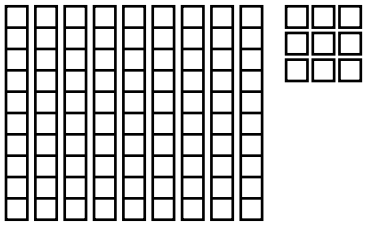

dezenas ____ unidades ____

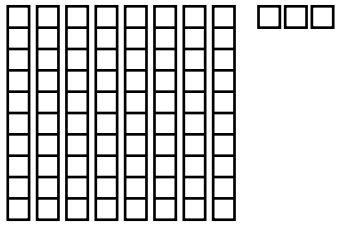

dezenas ____ unidades ____

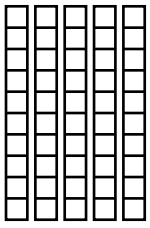

dezenas ____ unidades ____

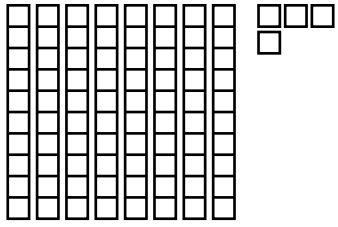

dezenas ____ unidades ____

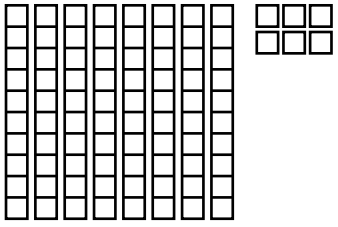

dezenas ____ unidades ____

Livre para uso em casa e na escola. Não revender ou republicar.