Nome: _____ Data: _____/_____/_____

Divisão armada: 2 algarismos, resto zero

Use a chave: divida, multiplique, subtraia e continue.

1) 39 | 3

2) 44 | 4

3) 48 | 2

4) 90 | 5

5) 30 | 2

6) 72 | 3

7) 95 | 5

8) 22 | 2

9) 48 | 4

10) 42 | 3

11) 55 | 5

12) 64 | 4

Livre para uso em casa e na escola. Não revender ou republicar.

Nome: _____ Data: _____/_____/_____

Divisão armada: 2 algarismos, com resto

Escreva o quociente embaixo do divisor e o resto embaixo do dividendo.

1)

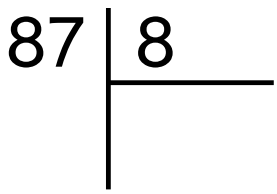

2)

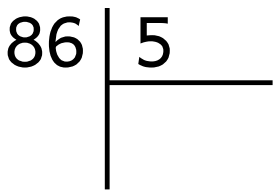

3)

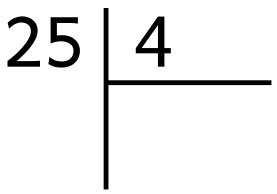

4)

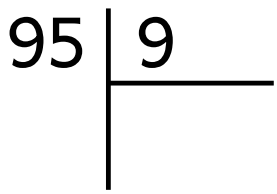

5)

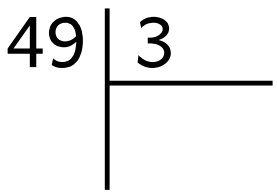

6)

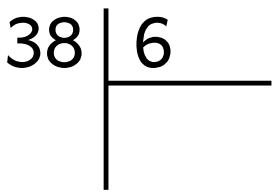

7)

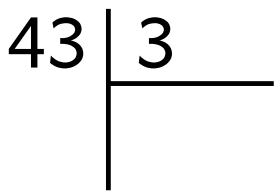

8)

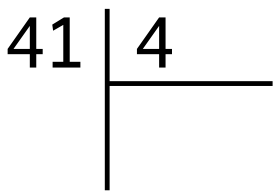

9)

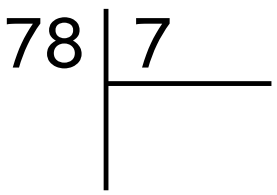

10)

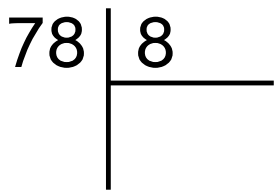

11)

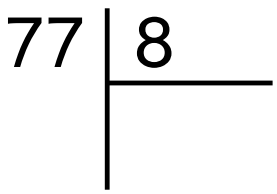

12)

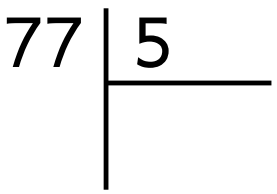

Livre para uso em casa e na escola. Não revender ou republicar.

Nome: _____ Data: _____/_____/_____

Divisão armada: 3 algarismos, resto zero

Divida a centena, depois a dezena, depois a unidade.

1) 424 | 4

2) 316 | 4

3) 201 | 3

4) 222 | 3

5) 340 | 4

6) 306 | 6

7) 308 | 4

8) 248 | 4

9) 360 | 3

10) 520 | 4

11) 240 | 3

12) 130 | 2

Livre para uso em casa e na escola. Não revender ou republicar.

Nome: _____ Data: _____/_____/_____

Divisão armada: 3 algarismos, com resto

O resto é sempre menor que o divisor.

1) 853 | 9

2) 305 | 4

3) 145 | 3

4) 244 | 7

5) 761 | 7

6) 429 | 9

7) 789 | 7

8) 761 | 9

9) 435 | 6

10) 723 | 9

11) 282 | 7

12) 368 | 7

Livre para uso em casa e na escola. Não revender ou republicar.