Nome: _____ Data: _____/_____/_____

Qual é o nome da figura? (gabarito)

Escreva na linha o nome de cada figura: círculo, quadrado, retângulo ou triângulo.

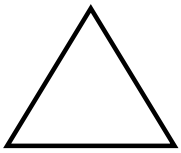

triângulo

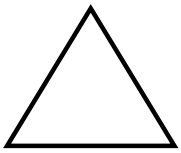

triângulo



retângulo



círculo



círculo



quadrado



quadrado



retângulo

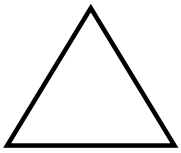

triângulo



quadrado



retângulo



círculo

Livre para uso em casa e na escola. Não revender ou republicar.