Nome: _____ Data: _____/_____/_____

Lados e vértices das figuras (gabarito)

Conte os lados e os vértices (pontas) de cada figura e escreva o nome dela.

	lados	vértices	nome
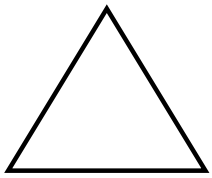	3	3	triângulo
	4	4	quadrado
	4	4	retângulo
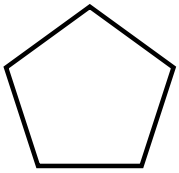	5	5	pentágono
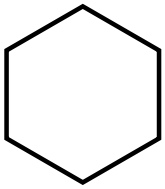	6	6	hexágono

Livre para uso em casa e na escola. Não revender ou republicar.