Nome: _____ Data: _____/_____/_____

Lados e vértices das figuras

Conte os lados e os vértices (pontas) de cada figura e escreva o nome dela.

	lados	vértices	nome
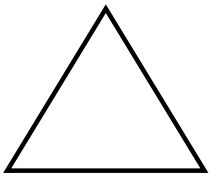			_____
			_____
			_____
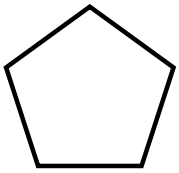			_____
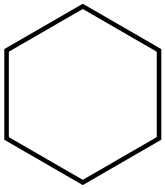			_____

Livre para uso em casa e na escola. Não revender ou republicar.