Nome: _____ Data: _____/_____/_____

Qual é o nome da figura? (gabarito)

Escreva na linha o nome de cada figura: círculo, quadrado, retângulo ou triângulo.

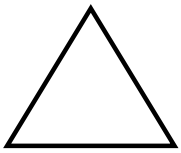

triângulo

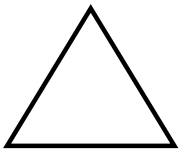

triângulo



retângulo



círculo



círculo



quadrado



quadrado



retângulo

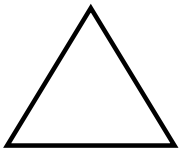

triângulo



quadrado



retângulo



círculo

Livre para uso em casa e na escola. Não revender ou republicar.

Nome: _____ Data: _____/_____/_____

Conte as figuras (gabarito)

Conte quantas figuras de cada tipo aparecem e escreva na caixinha.

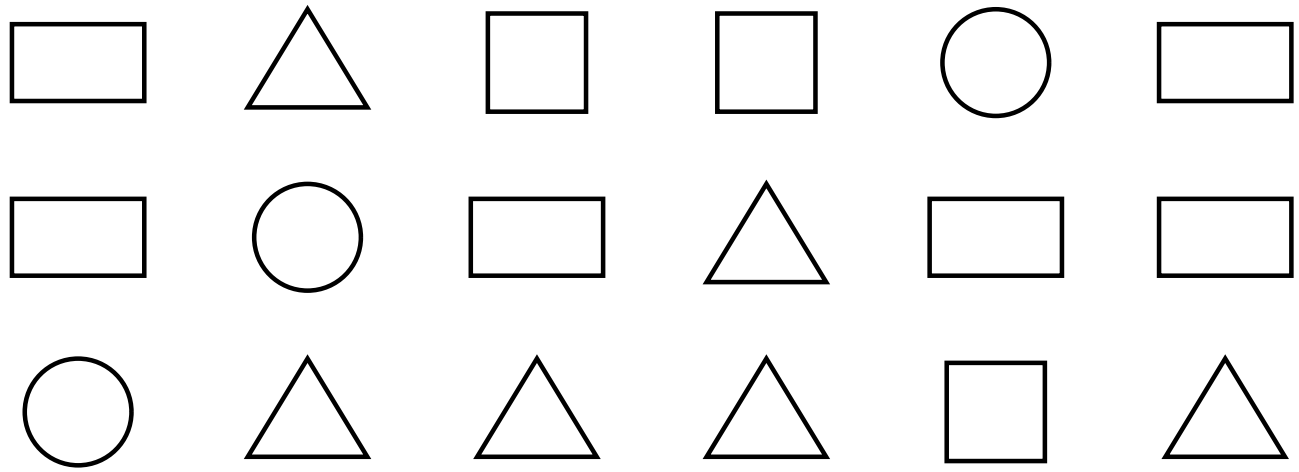



Livre para uso em casa e na escola. Não revender ou republicar.

Nome: _____ Data: _____/_____/_____

Pinte a figura pedida (gabarito)

Leia o que cada fila pede e pinte só as figuras certas.

Pinte todos os círculos.



Pinte todos os quadrados.

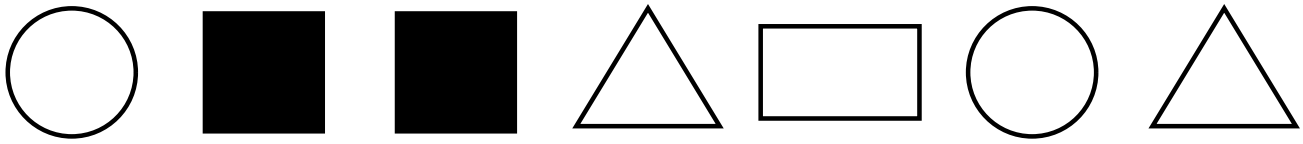

Pinte todos os retângulos.



Pinte todos os triângulos.



Livre para uso em casa e na escola. Não revender ou republicar.

Nome: _____ Data: _____/_____/_____

Lados e vértices das figuras (gabarito)

Conte os lados e os vértices (pontas) de cada figura e escreva o nome dela.

	lados	vértices	nome
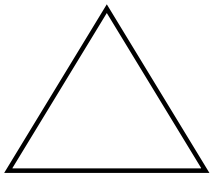	3	3	triângulo
	4	4	quadrado
	4	4	retângulo
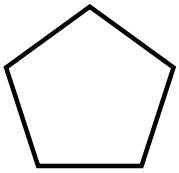	5	5	pentágono
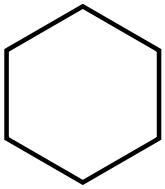	6	6	hexágono

Livre para uso em casa e na escola. Não revender ou republicar.