Nome: _____ Data: _____/_____/_____

Pinte a fração indicada: metades e quartos

Cada figura está dividida em partes iguais. Pinte a quantidade indicada pela fração.



Pinte $\frac{1}{2}$



Pinte $\frac{1}{2}$

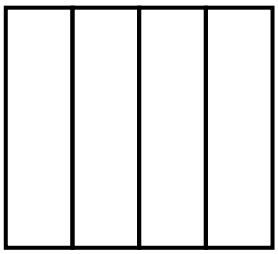

Pinte $\frac{1}{4}$

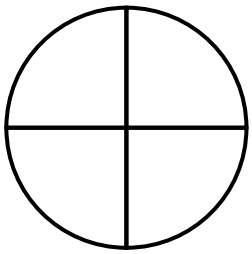

Pinte $\frac{1}{4}$

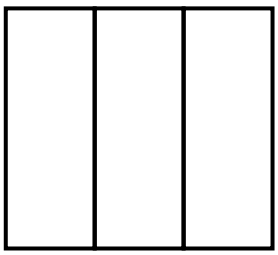

Pinte $\frac{1}{3}$



Pinte $\frac{1}{3}$

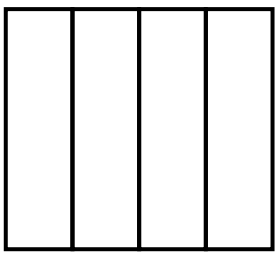

Pinte $\frac{2}{4}$

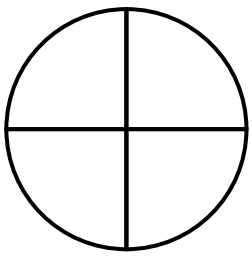

Pinte $\frac{3}{4}$

Livre para uso em casa e na escola. Não revender ou republicar.