Nome: _____ Data: _____/_____/_____

Pinte a fração indicada: terços a oitavos (gabarito)

Conte as partes da figura e pinte quantas a fração pede.



Pinte $\frac{2}{3}$

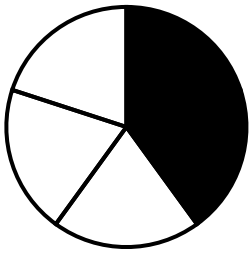

Pinte $\frac{2}{5}$



Pinte $\frac{3}{5}$

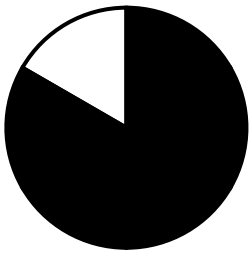

Pinte $\frac{5}{6}$

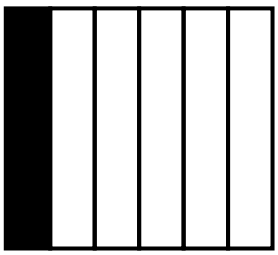

Pinte $\frac{1}{6}$

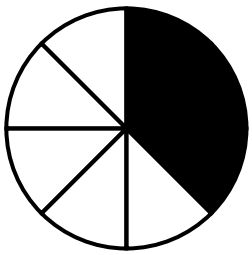

Pinte $\frac{3}{8}$



Pinte $\frac{5}{8}$

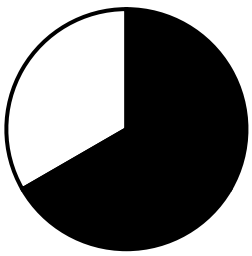

Pinte $\frac{2}{3}$

Livre para uso em casa e na escola. Não revender ou republicar.