Nome: _____ Data: _____/_____/_____

Que fração está pintada? (gabarito)

Conte todas as partes e depois as partes pintadas. Escreva a fração.



Fração pintada: $\frac{2}{4}$

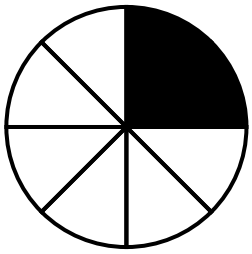

Fração pintada: $\frac{2}{8}$

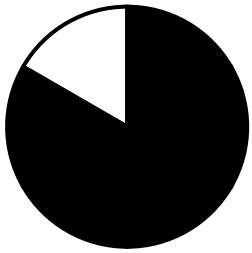

Fração pintada: $\frac{5}{6}$

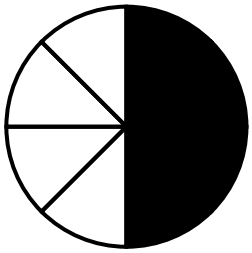

Fração pintada: $\frac{4}{8}$

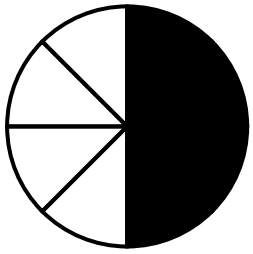

Fração pintada: $\frac{4}{8}$

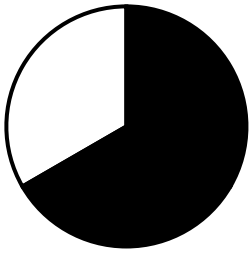

Fração pintada: $\frac{2}{3}$

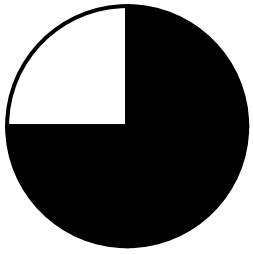

Fração pintada: $\frac{3}{4}$



Fração pintada: $\frac{3}{5}$

Livre para uso em casa e na escola. Não revender ou republicar.