Nome: _____ Data: _____/_____/_____

Que fração está pintada?

Conte todas as partes e depois as partes pintadas. Escreva a fração.



Fração pintada: ☐

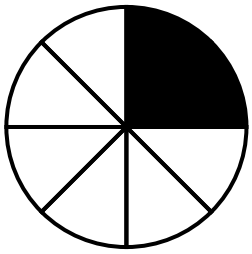

Fração pintada: ☐

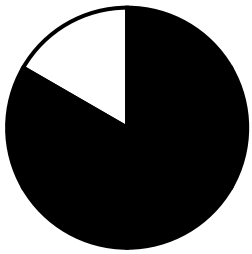

Fração pintada: ☐

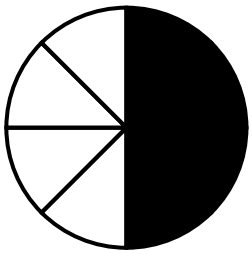

Fração pintada: ☐

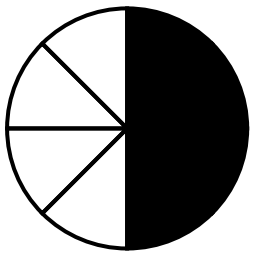

Fração pintada: ☐

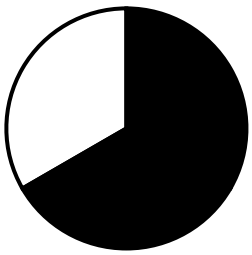

Fração pintada: ☐

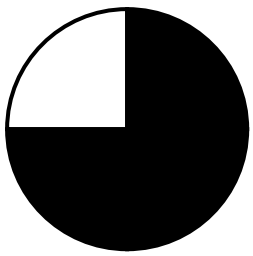

Fração pintada: ☐



Fração pintada: ☐

Livre para uso em casa e na escola. Não revender ou republicar.