Nome: _____ Data: _____/_____/_____

Qual fração unitária é maior? (gabarito)

As barras têm o mesmo tamanho. Circule a fração com a parte maior: quanto menos partes, maior cada parte.

1/2 	**1/4** 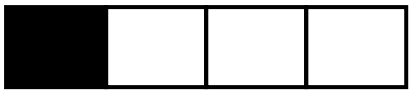
1/3 	**1/6** 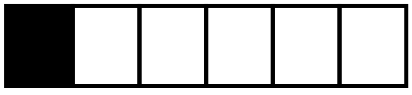
1/2 	**1/3** 
1/4 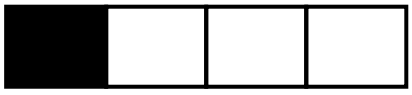	**1/8** 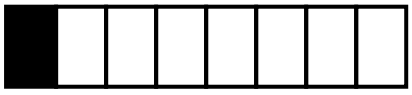
1/5 	**1/10** 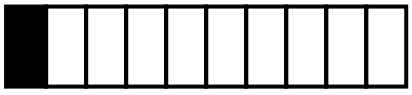
1/3 	**1/4** 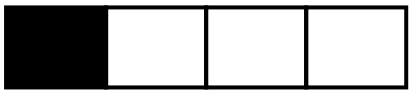
1/2 	**1/5** 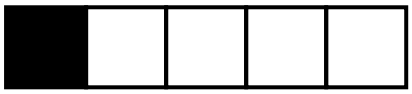
1/3 	**1/6** 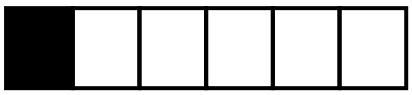

Livre para uso em casa e na escola. Não revender ou republicar.