Nome: _____ Data: _____/_____/_____

Qual fração unitária é maior?

As barras têm o mesmo tamanho. Circule a fração com a parte maior: quanto menos partes, maior cada parte.

$\frac{1}{2}$ 	$\frac{1}{4}$ 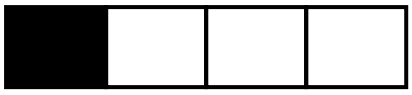
$\frac{1}{3}$ 	$\frac{1}{6}$ 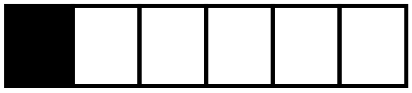
$\frac{1}{2}$ 	$\frac{1}{3}$ 
$\frac{1}{4}$ 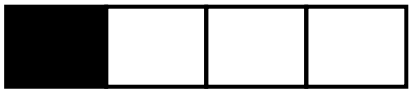	$\frac{1}{8}$ 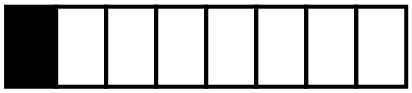
$\frac{1}{5}$ 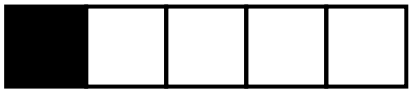	$\frac{1}{10}$ 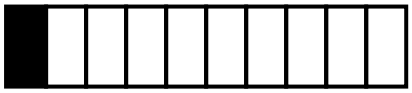
$\frac{1}{3}$ 	$\frac{1}{4}$ 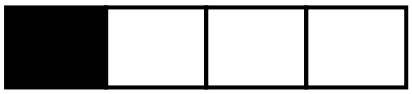
$\frac{1}{2}$ 	$\frac{1}{5}$ 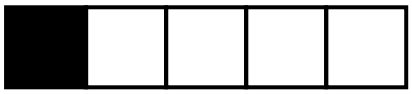
$\frac{1}{3}$ 	$\frac{1}{6}$ 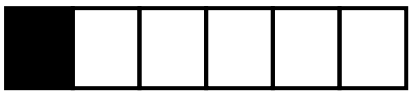

Livre para uso em casa e na escola. Não revender ou republicar.