Nome: _____ Data: _____/_____/_____

Conte e escreva de 11 a 20 (gabarito)

Conte os desenhos de cada quadro e escreva o total na caixinha.



Total: **20**



Total: **14**

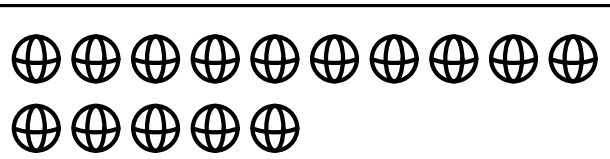

Total: **15**



Total: **18**

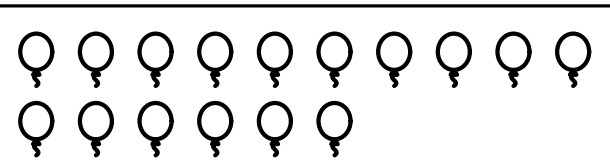

Total: **16**

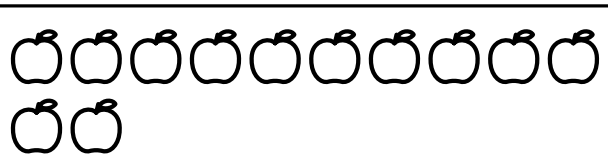

Total: **12**

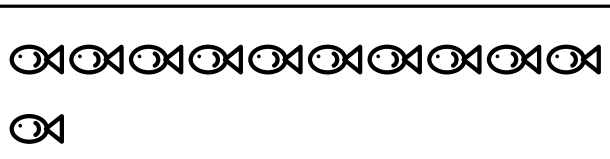

Total: **11**

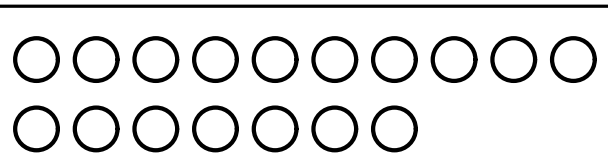

Total: **17**

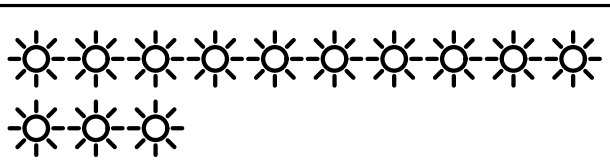

Total: **13**



Total: **19**

Livre para uso em casa e na escola. Não revender ou republicar.

Nome: _____ Data: _____/_____/_____

Complete a sequência de 11 a 20 (gabarito)

Escreva os números que faltam em cada fila.

11	12	13	**14**	**15**
13	14	**15**	**16**	17
12	13	**14**	**15**	16
15	16	**17**	**18**	19
11	12	**13**	**14**	15
14	15	**16**	17	18
16	17	18	19	**20**
12	13	14	**15**	16

Livre para uso em casa e na escola. Não revender ou republicar.