Nome: _____ Data: _____/_____/_____

Décimos: quanto está pintado? (gabarito)

A barra toda vale 1 e cada pedaço vale 0,1. Escreva o número decimal.



= **0,9**



= **0,5**

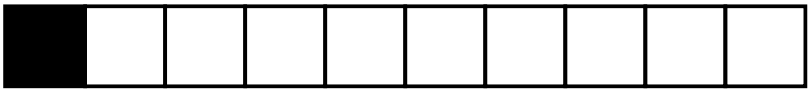

= **0,1**

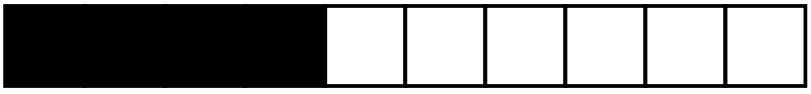

= **0,4**



= **0,7**



= **0,8**

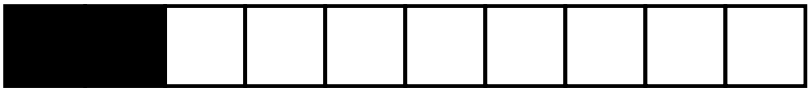

= **0,2**

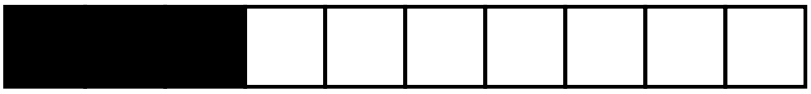

= **0,3**

Livre para uso em casa e na escola. Não revender ou republicar.