Nome: _____ Data: _____/_____/_____

Décimos: quanto está pintado?

A barra toda vale 1 e cada pedaço vale 0,1. Escreva o número decimal.

 = _____

 = _____

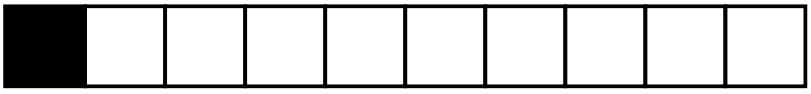 = _____

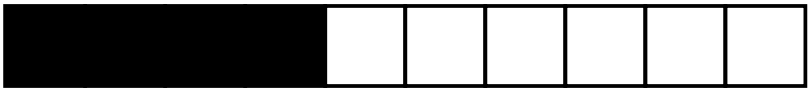 = _____

 = _____

 = _____

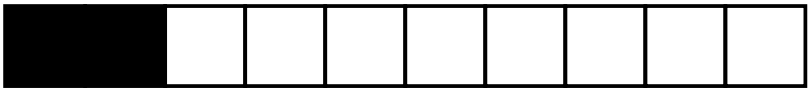 = _____

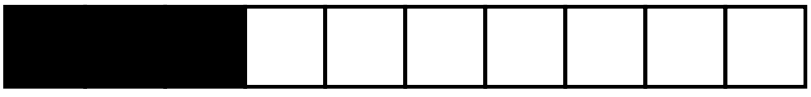 = _____

Livre para uso em casa e na escola. Não revender ou republicar.