Nome: _____ Data: _____/_____/_____

Desenhe os ponteiros: hora cheia e meia hora (gabarito)

Desenhe o ponteiro pequeno (das horas) e o grande (dos minutos) para marcar a hora escrita.



10:30



12:00



09:30



08:00



04:30



05:00



02:30



07:00



11:30



01:00



03:30



06:00

Livre para uso em casa e na escola. Não revender ou republicar.