Nome: _____ Data: _____/_____/_____

Desenhe os ponteiros: minutos de 5 em 5 (gabarito)

Desenhe os ponteiros para marcar cada hora escrita. Lembre que o ponteiro pequeno anda entre os números.



11:55



11:05



07:55



10:40



10:50



12:20



02:40



05:45



02:45



02:50



11:10



06:40

Livre para uso em casa e na escola. Não revender ou republicar.